Place Value: Teen Numbers

Name: _____ Date: _____

Directions: Write to tell how many tens and ones.

1. 17 is____ ten and ____ ones.
2. 14 is____ ten and ____ ones.
3. 12 is____ ten and ____ ones.
4. 18 is____ ten and ____ ones.
5. 13 is____ ten and ____ ones.
6. 19 is____ ten and ____ ones.

Directions: Write the number the blocks show.

7.

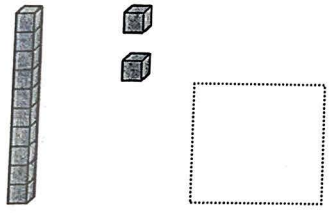

8.

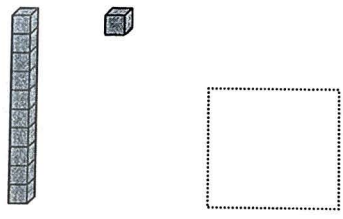

9.

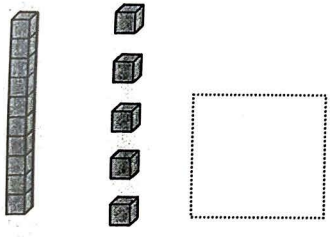

10.

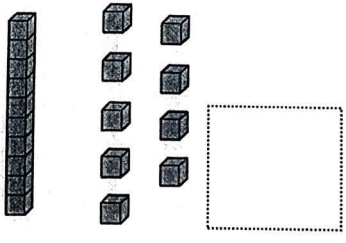

1.NBT.2b

Name _____

R and L Blends



Directions: Say the name of each picture. Write the word on the line. Circle the beginning blend for each word.



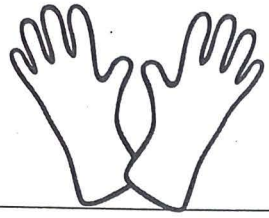



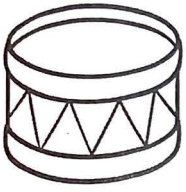





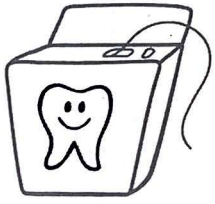











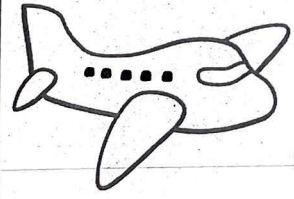





nie Moffatt © The Moffatt Girls 2013



On sunny days, I like to

_____

_____

_____

Place Value: Tens & Ones

Name: _____ Date: _____

Directions: Write the number.

1. **Two** tens and **four** ones is _____.
2. **Three** tens and **three** ones is _____.
3. **Six** tens and **eight** ones is _____.
4. **Five** tens and **two** ones is _____.
5. **Seven** tens and **one** one is _____.
6. **Four** tens and **six** ones is _____.

Directions: Draw the number with base ten blocks.

73	**58**
27	**45**

1.NBT.2

Teacher Tam

rections Look at the
cture in each box
rite the beginning
graph (th, wh, sh, or ch)
r each picture.

Beginning Digraphs



If that cat came to my house, I would